Sides and corners

Name: _____ Date: _____

Trace each shape's outline with a finger on the paper. Count its straight sides and corners, then write both numbers. Each shape is closed.

1

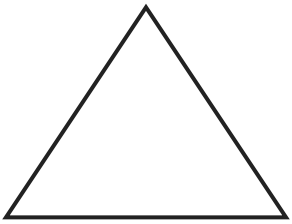

Sides: ___ Corners: ___

2



Sides: ___ Corners: ___

3

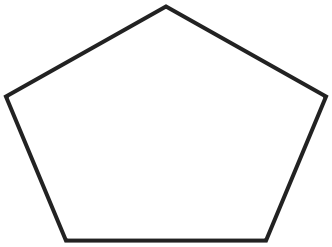

Sides: ___ Corners: ___

4

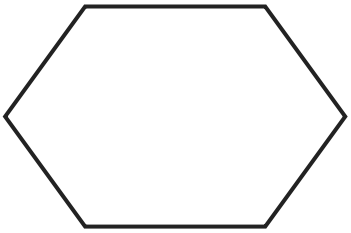

Sides: ___ Corners: ___